**Name:** …….. **GRADE 5**

**History & Geography ( Revision exercises )** **Working with maps 1**

**1. Study Map 1 carefully. Then answer questions (a), (b) and (c).**

**Map 1**

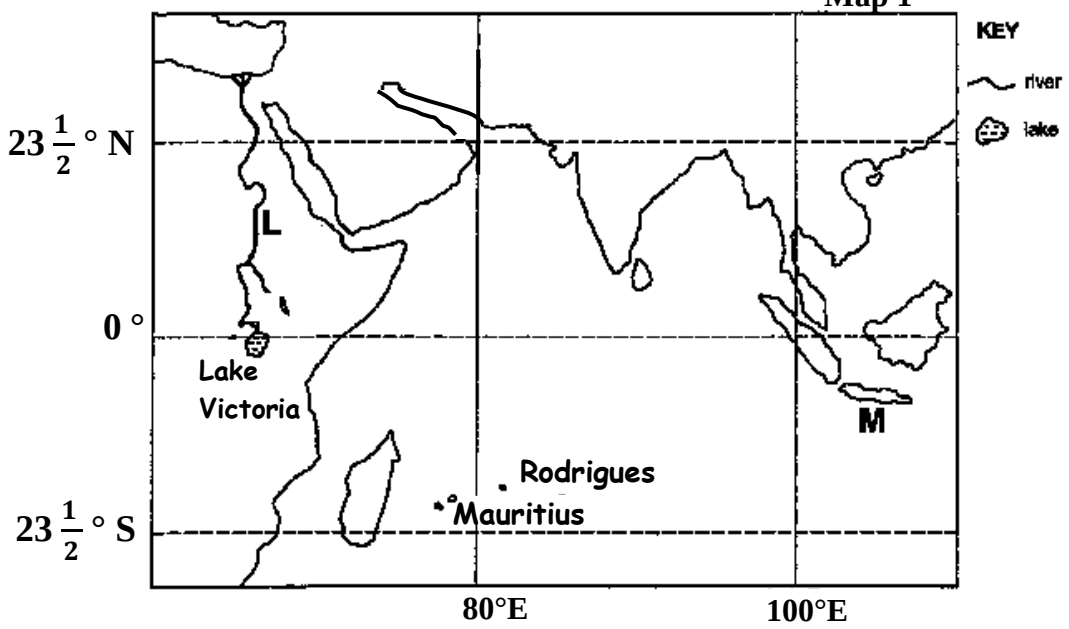


**(a)** The **line of latitude** which crosses Lake Victoria is ……..….

**A** Antarctic Circle **B** Tropic of Capricorn

**C** Equator **D** Tropic of Cancer

**(b)** River **L** is the …….. .

**A** Amazon **B** Ganges **C** Indus **D** Nile

**(c)** Island **M** from where sugar cane was brought to Mauritius is …….

**A** Java **B** Thailand **C** Malaysia **D** Bangladesh

---

**2.** Study diagram 1. Line **Q** is the …….

**A** Equator

**B** Tropic of Capricorn

**C** Greenwich Meridian

**D** Tropic of Cancer

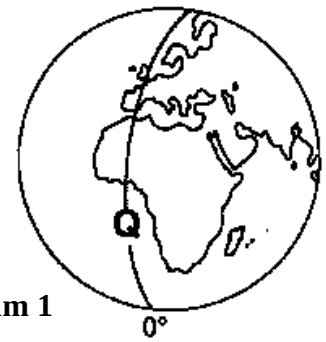


**Diagram 1**

---

**3.** **Map 2** shows the island of Rodrigues.

Most of the big villages are located …….

**A** at Plaine Corail

**B** along the coast

**C** at the mouth of rivers

**D** along the Central Ridge
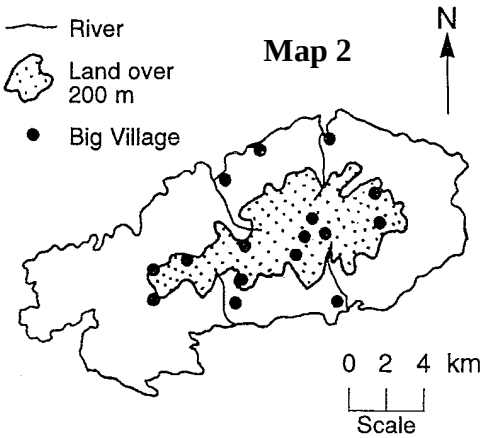
**Map 2**